Name: _____ Primary 5-a-day Silver

7th July

$\frac{1}{3}$ of 27

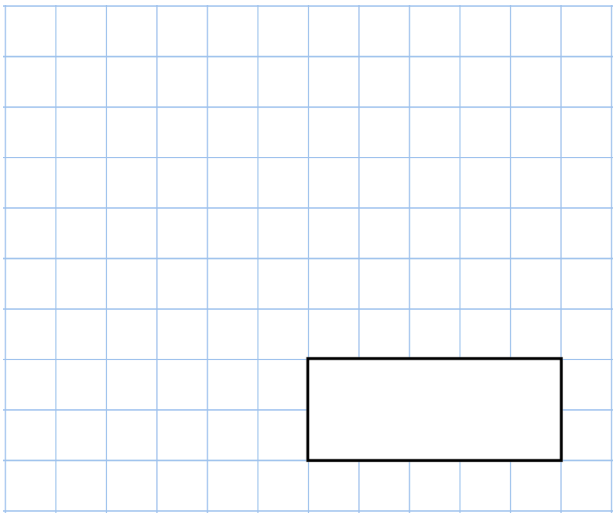

$121 \div 11$

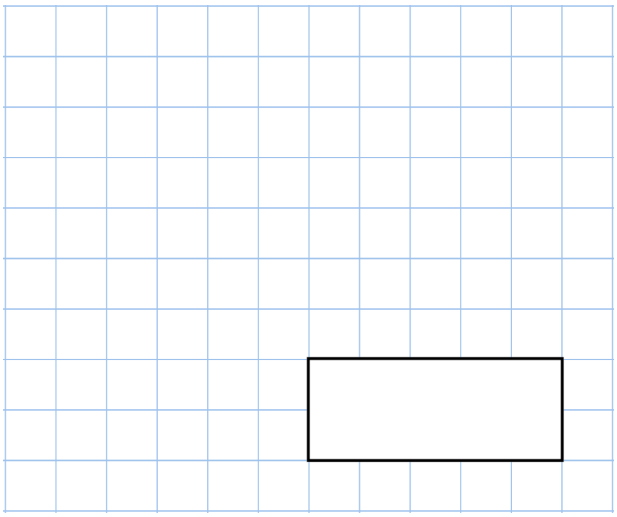

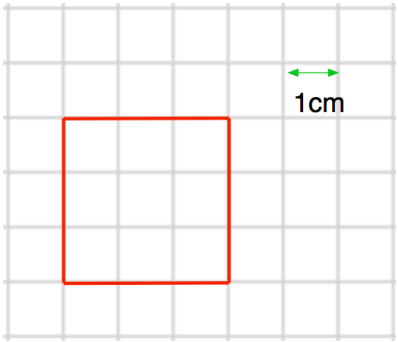

Write down the area of the square

Here is part of a number sequence.

The numbers in the sequence increase by 40 each time.

40 80 120 160 ...

Circle **all** of the number below that will appear in the sequence

195 210 240 250

300 320 390 400

Super Bowl LIV will take place in 2020

Write LIV in **figures**